Verifica di geometria

Alunno _____ Classe _____

✐ A. Scrivi i nomi dei seguenti triangoli. Attenzione, l'occhio non basta: usa il righello per misurare i lati.

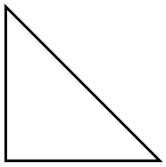

Triangolo

_____

_____

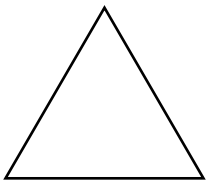

_____

_____

_____

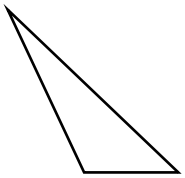

_____

_____

_____

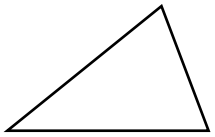

_____

_____

_____

✐ B. Scrivi i cartellini del diagramma di Eulero-Venn qui rappresentato.

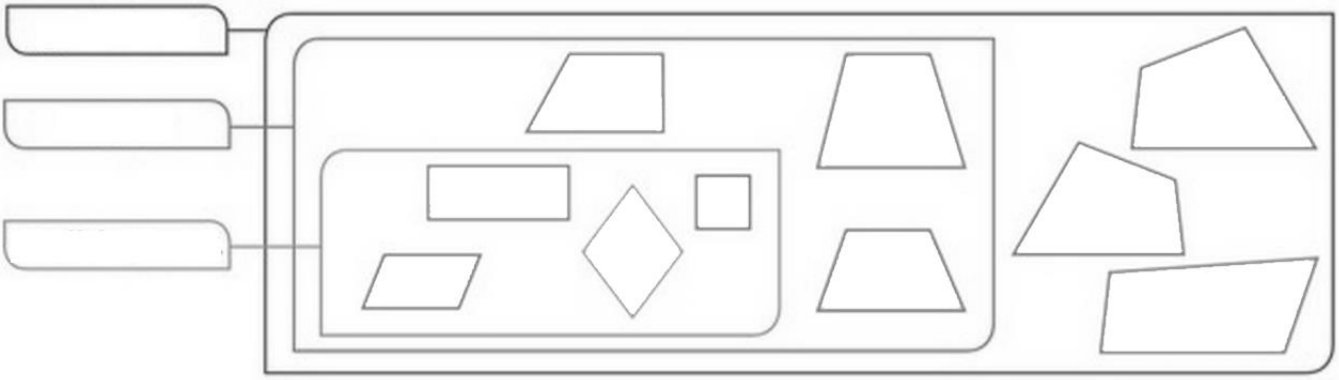

✐C. Osserva le seguenti figure e scrivi sotto ognuna **quadrilatero**, **trapezio** o **parallelogramma**.

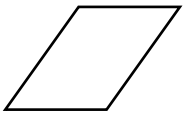

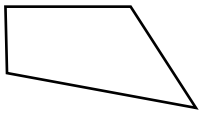

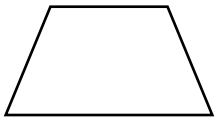

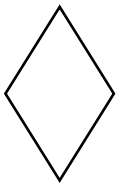

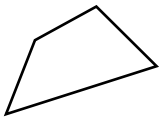

_____ _____ _____ _____ _____

✐D. Completa il testo.

I quadrilateri sono poligoni che hanno _____ lati e _____ angoli.

I quadrilateri che hanno una coppia di lati paralleli si chiamano _____ .

I quadrilateri che hanno due coppie di lati paralleli si chiamano _____ .

La somma degli angoli interni di un quadrilatero è di _____ .

✐E. Disegna con il righello le figure seguenti.

QUADRATO RETTANGOLO TRAPEZIO RETTANGOLO